TDAJ's Yr5 & Yr6
Hall of Fame
Week 6

As I sat by my study window with my second whiskey, I stared at the common in fear. The colour and size of the fire shivered my spine in ice. I am worried, terrified and petrified about what the future will end up as in Europe or even worse, the whole universe!

My mind flashed back to when I was bringing back the cart for the innkeeper but now on the floor dead. I've had enough thinking about that cart especially with that 'Thing' on its tripod legs.Oh, and poor Ogilvy. And I hated that awful storm and the thought of me dragging myself across the ditch to finally get myself HOME..

Extract of…

English

Azuka – Year 6

Alan walker

Songs:

- Darkside
- Faded
- Alone

Alan Olav Walker is an English/Norwegian DJ born on the 24th August 1997 and is renowned for his popular songs stated above. He was born in Northampton England and has a NetWorth of about £15 million. His father, Philip Alan Walker, is of British origin, and his mother, Hilde Omdal Walker, is of Norwegian origin. Walker holds dual citizenship (Norway and Britain). He has an elder sister, Camilla Joy, and a younger brother, Andreas. in his early years, Walker was inclined towards computers, and graphic designing.

In 2012, he listened to a song composed by David Whistle. Walker contacted the musician, to understand how the music was produced. After listening to music composers, such as Hans Zimmer, and Steve Jablonsky, Walker became more interested in music production. He did not receive any formal training in music. Walker learned music production by watching the "YouTube" tutorials on the topic.

Music – Artist Fact File

Bernie – Year 6

As I sit at my study window, with another massive glass of whiskey, I wonder whether this will ever come to an end- Will I ever see daylight again? I look out into the common and my heart melts like an ice-cream in the sun; I'm scared, I'm nervous, I'm terrified- what will be the future not only for England, but for the whole world? ...

I thought back to the ten cylinders that had fired at us from Mars, with hail and thunder roaring above us. Remembering that extremely hard time made me feel nauseous. I thought about the terror, the fear that I felt... no one should experience it.

I thought back to the sad journey that I had bringing back the cart that I had borrowed from the innkeeper-who was now lying dead in his house. He doesn't need his cart anymore. Thinking about the Martians made me feel sick; they would mercilessly kill people without caring.

I must try to get some sleep. No one knows the cruelty they will put us through tomorrow. I need to be strong and carry on.

English

Al-Basit – Year 6

Dear diary,

Yesterday was the most horrible, traumatizing and shocking day! It all started when I arrived in the house, I was soaked to the bone and miserable, so I decided to go and get a glass of whiskey. I sat near the window and peered out, there was a blazing fire raging to my left I looked at it for a while only to realise it was an upturned train burned from the heat-ray! I looked towards the common again only to see that the Martians were amazingly busy scurrying to and fro among their cylinders.

I remember a soldier had called me, so I let him inside and gave him a whiskey. It was a disturbing sight afterwards seeming he burst out crying once he finished his whiskey. It took me several minutes to calm him down and when I had, he explained how the Martians had used a shield to block our artillery barrage which then transformed into the first tripod. He explained how it killed all his comrades and how he hid behind a burnt horse's carcass and that he'd just managed to crawl back to the houses. Wait the Martians are settling down now, I might as well go and get some rest.

English – Diary Entry

Bernie – Year 6

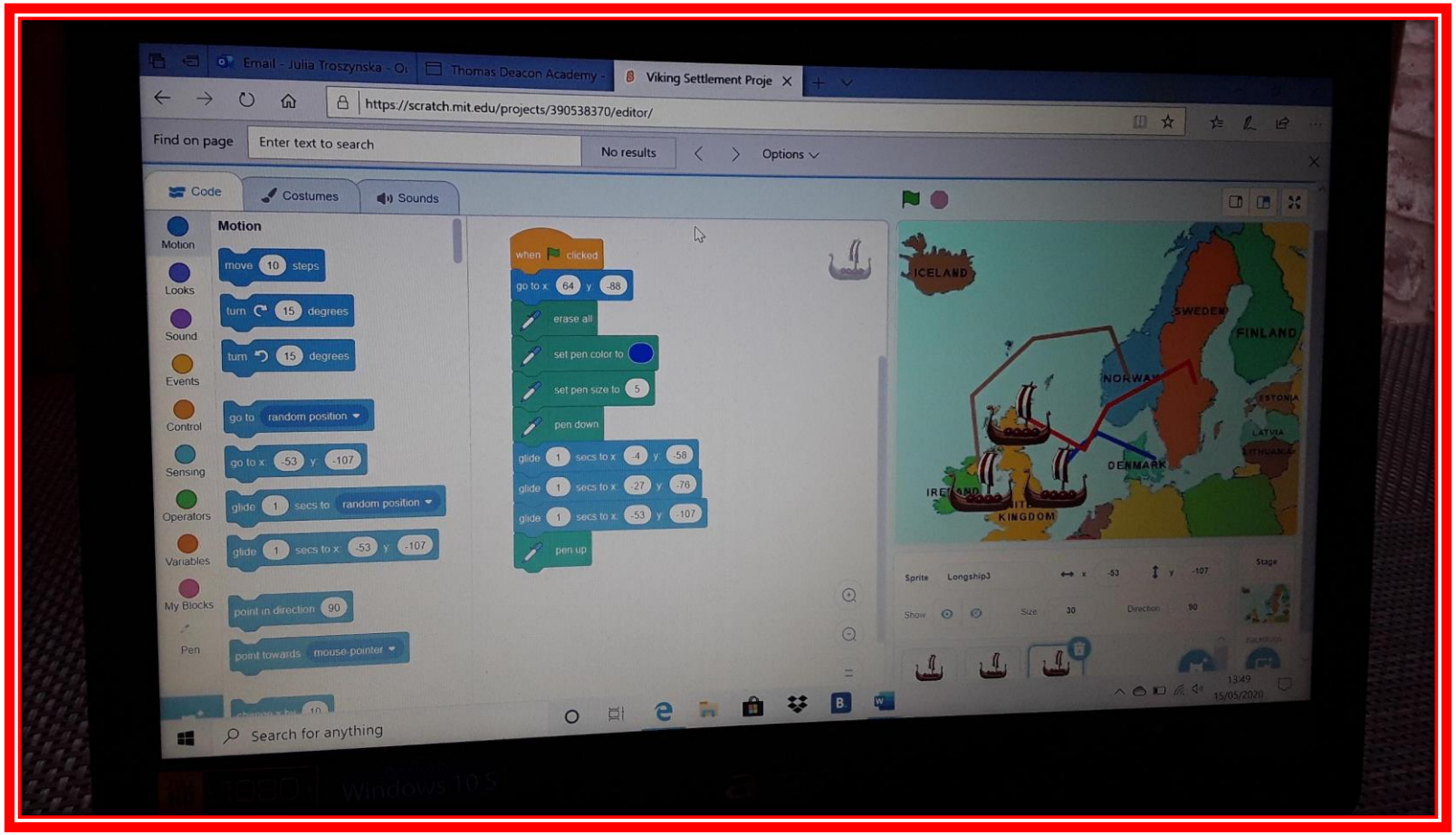

Computing – Scratch

Julia – Year 5



Art

Julia – Year 6

Art

Matheus – Year 5

Art

Matheus – Year 5



STEM Activity

Matheus – Year 5

English – Story

Bobby – Year 6

The Mysterious Animal

I have spotted something... I might sound crazy but I think I saw 3 legs, red nose, dark yellow fur, silver eyes and a mane like a lion. I researched for an animal that fitted the description but I couldn't find anything I looked more there was a thing called a mushi-mosha, but it was a myth thought to have existed many years ago. It was million upon million of years where you wouldn't be able to see it.

I was exploring the Mayan temples in Lacandon Jungle, in Mexico when I first saw it. I am like a madman now trying to find it again. As I dash through the thick jungle i can smell coconuts then I saw the plants steaming because it is so hot. Sweat falls down my face, I swipe it away as I rest and catch my breath for a second. The animal noises are deafening when all of a sudden everything stops and the only noise, I can hear is the sound of my own breathing. I have a chill down my spine as I freeze where I am. Why did the animals stop? What is happening?

SNAP

I hear a twig break behind me as if something has stood on it. I dare not look or move a muscle, I have goose bumps over my whole body and my breathing quickens with fear. I can hear whatever it is move closer and start to move around me. I close my eyes tightly thinking it will go away. It doesn't so I start to slowly open my eyes. Before I see the creature, I have been obsessed with finding. My description was spot on as was the information I had researched. Instead of feeling afraid I feel at peace. It then starts to shimmer in front of me its fur blurs and when I next blink it has vanished, and I am by myself once again. I am instantly deafened by the anima noises around me as they once again start, scaring me after the silence.

I have only had this experience with the mushi-mosha and my holiday is over but I am planning my next trip to the jungle to see if I can track it down again and learn more about it.

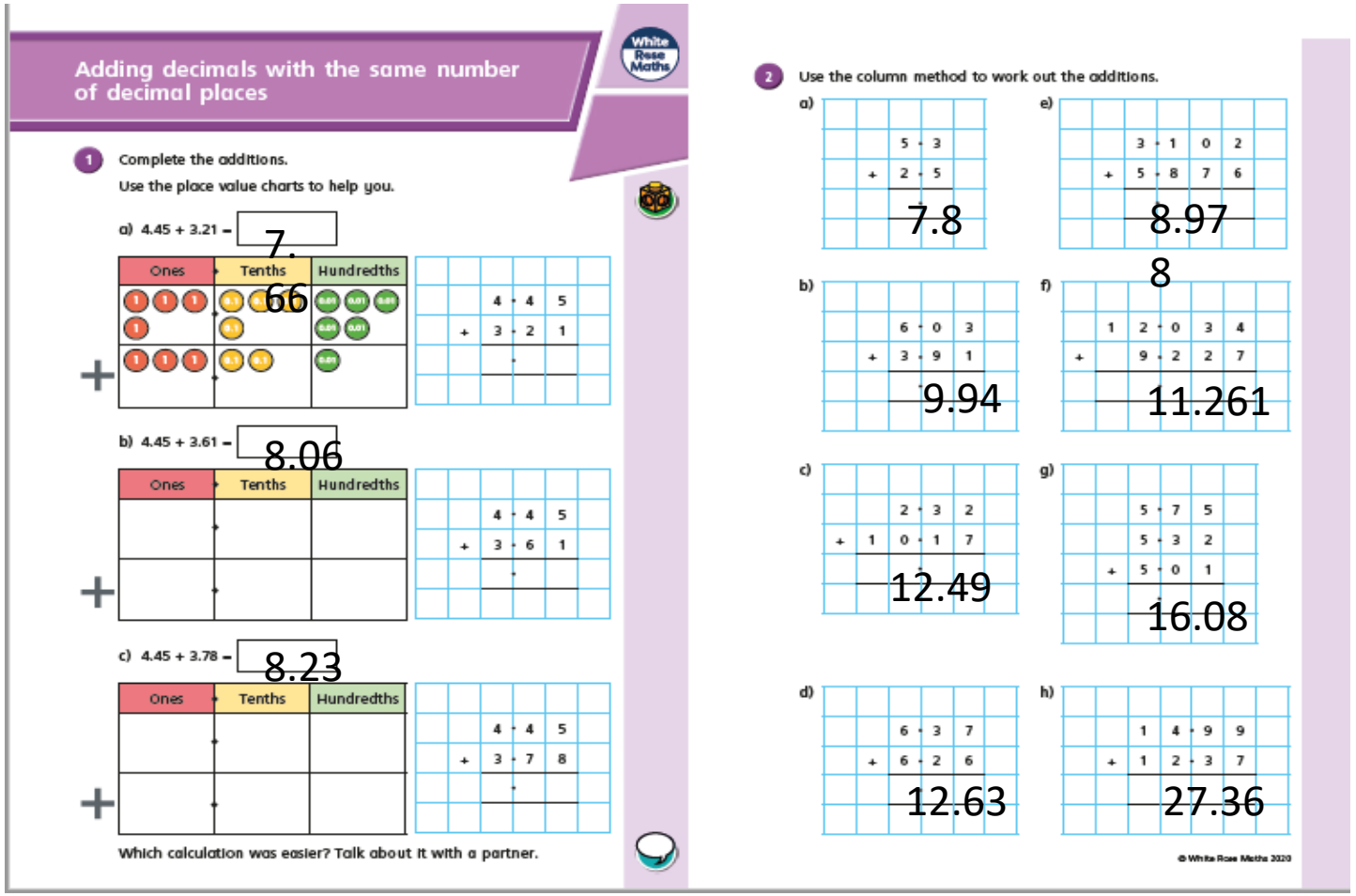

Adding decimals with the same number of decimal places

1 Complete the additions.
Use the place value charts to help you.

a) 4.45 + 3.21 = 7.66

Ones	Tenths	Hundredths
1 1 1 1	0.1 0.1	0.01 0.01 0.01 0.01 0.01
+ 1 1 1	0.1 0.1	0.01

	4	4	5
+	3	2	1

b) 4.45 + 3.61 = 8.06

Ones	Tenths	Hundredths
+		

	4	4	5
+	3	6	1

c) 4.45 + 3.78 = 8.23

Ones	Tenths	Hundredths
+		

	4	4	5
+	3	7	8

Which calculation was easier? Talk about it with a partner.

2 Use the column method to work out the additions.

a) 5.3 + 2.5 = 7.8

b) 6.0 + 3.9 = 9.94

c) 2.3 + 10.17 = 12.49

d) 6.37 + 6.26 = 12.63

e) 3.102 + 5.876 = 8.978

f) 12.034 + 9.227 = 11.261

g) 5.75 + 5.32 + 5.01 = 16.08

h) 14.99 + 12.37 = 27.36

© White Rose Maths 2020

Maths – Decimals

Myriam – Year 5

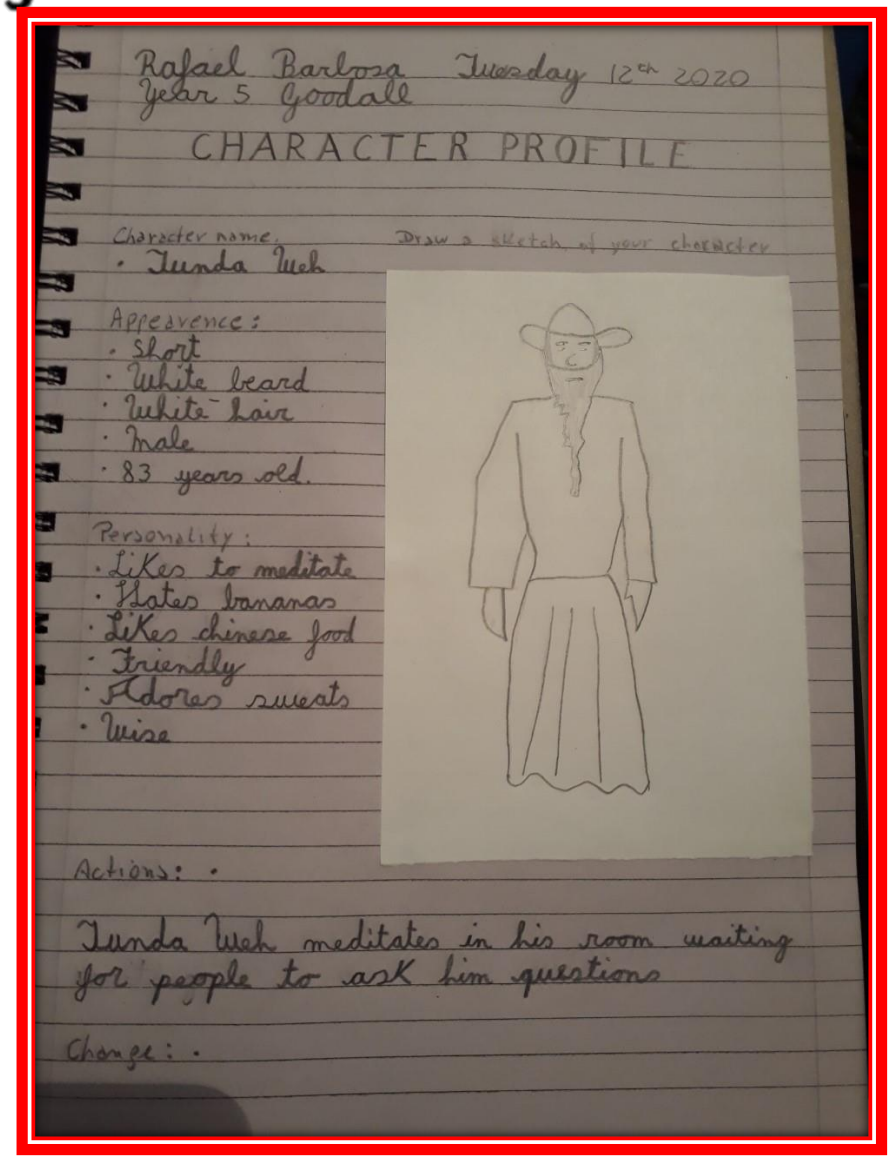

Rafael Barbosa Tuesday 12th 2020
Year 5 Goodale

CHARACTER PROFILE

Character name:
· Tunda Weh

Draw a sketch of your character

Appearence:
· Short
· White beard
· White hair
· Male
· 83 years old.

Personality:
· Likes to meditate
· Hates bananas
· Likes chinese food
· Friendly
· Adores sweets
· Wise

Actions: ·

Tunda Weh meditates in his room waiting for people to ask him questions

Change: ·

English – Character Profile

Rafael – Year 5

Art

Rafael – Year 5

Art

Sabreen – Year 5

As I'm sitting at my study table a bottle of whisky by my side. thinking of the darkest thoughts I could consider. thinking of nothing but darkness. what's going to happen in the near future. Is it going to be destruction? is something going to change? What is going to happen to England and the people. What's going to happen to the whole world. Is it going to be pure destruction or is it going to be peaceful?

Mixed emotions running through my mind. I remembered the time of when I had that horrible journey getting that cart for the innkeeper. Now he is dead on his feet. I just remember his body in front of me. The memory of him gave me paranoia. I felt sick to the stomach. stomach rumbling as if I hadn't eaten in a week.

Still thinking about innkeeper; I then thought about the monster with the eerie tentacles. thinking about that and the innkeeper gives me massive paranoia. The spine-chilling tentacles waving around was the ugliest thing I've ever seen.

I don't know what to do, I have all these dreadful thoughts in my brain. I need to get rid of them: if that is possible. I tried keeping calm. what is happening in the future. I need to be fearless and help!

English (with editing)

Saif – Year 6

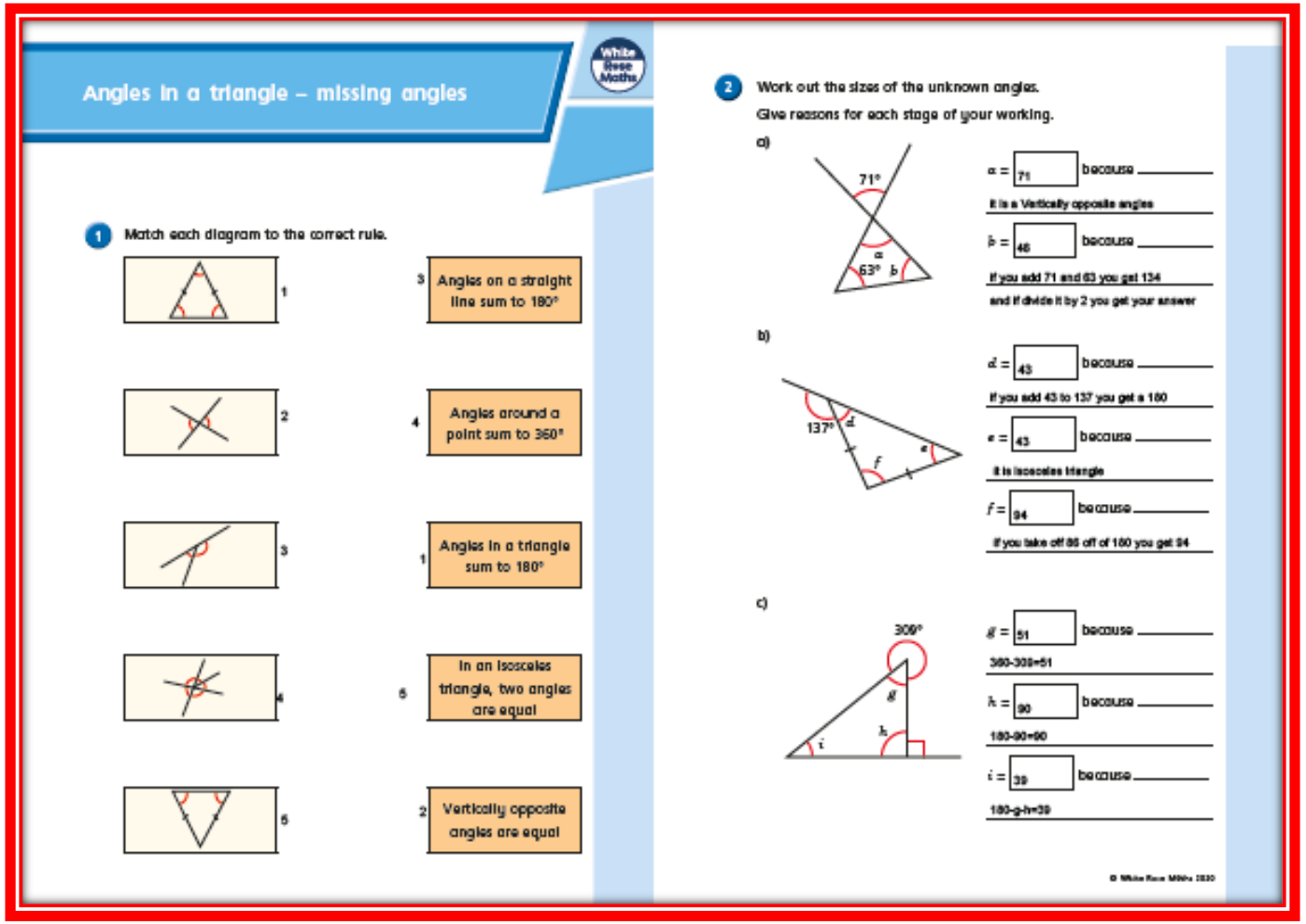

Angles in a triangle – missing angles

1 Match each diagram to the correct rule.

1		3	Angles on a straight line sum to 180°
2		4	Angles around a point sum to 360°
3		1	Angles in a triangle sum to 180°
4		5	In an isosceles triangle, two angles are equal
5		2	Vertically opposite angles are equal

2 Work out the sizes of the unknown angles.
Give reasons for each stage of your working.

a)

71°, 63°, a, b

a = 71 because _____
It is a Vertically opposite angles

b = 46 because _____
If you add 71 and 63 you get 134
and if divide it by 2 you get your answer

b)

137°, d, e, f

d = 43 because _____
If you add 43 to 137 you get a 180

e = 43 because _____
It is isosceles triangle

f = 94 because _____
If you take off 86 off of 180 you get 94

c)

309°, g, h, i

g = 51 because _____
360-309=51

h = 90 because _____
180-90=90

i = 39 because _____
180-g-h=39

© White Rose Maths 2020

Maths – Angles

Samuel – Year 6



STEM Activity

Sumayyah L – Year 5

Art

Adrians – Year 5

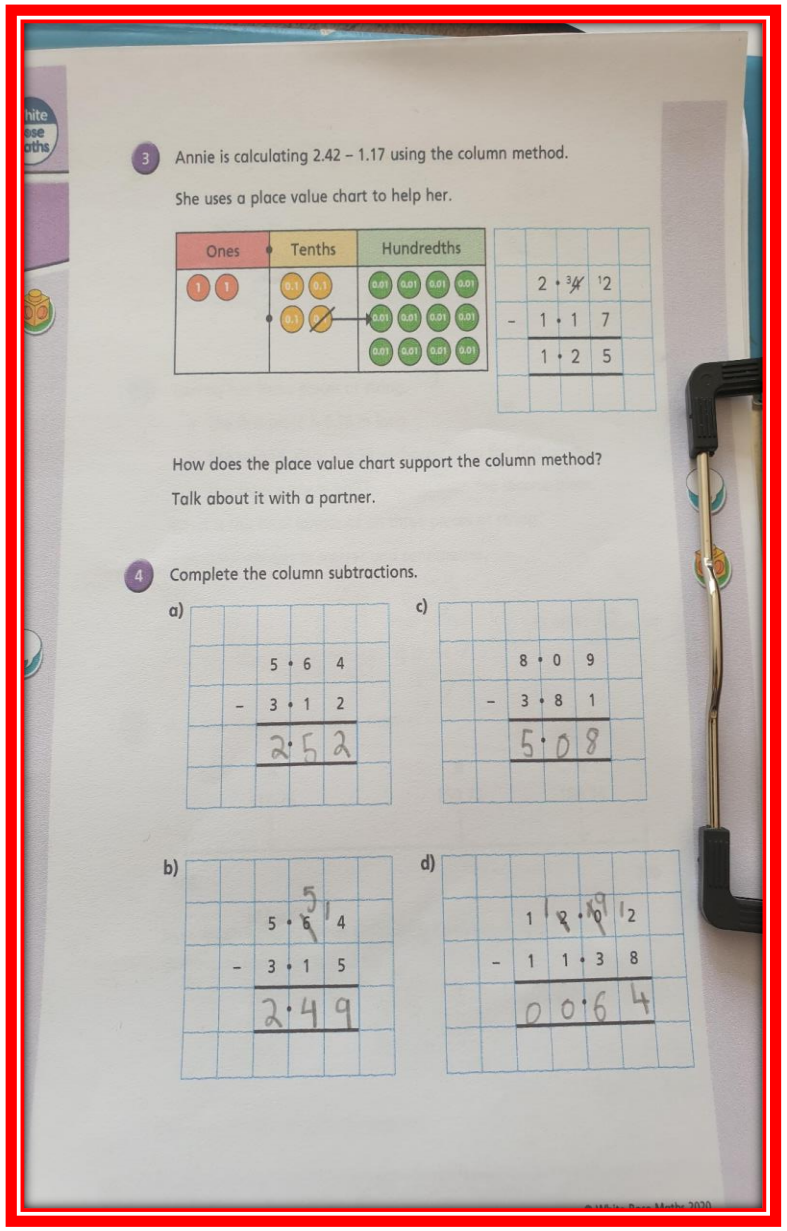

3 Annie is calculating 2.42 – 1.17 using the column method.

She uses a place value chart to help her.

Ones	Tenths	Hundredths
1 1	0.1 0.1 0.1 ~~0.1~~	0.01 0.01 0.01 0.01 0.01 0.01 0.01 0.01 0.01 0.01 0.01 0.01

	2	~~4~~ 3	12
–	1	1	7
	1	2	5

How does the place value chart support the column method?

Talk about it with a partner.

4 Complete the column subtractions.

a)

	5	6	4
–	3	1	2
	2	5	2

c)

	8	0	9
–	3	8	1
	5	0	8

b)

	5	~~6~~ 5	14
–	3	1	5
	2	4	9

d)

	1	~~2~~ 1	~~0~~ 19	12
–	1	1	3	8
	0	0	6	4

Maths

Aleeza – Year 5

Science

Daniel – Year 5

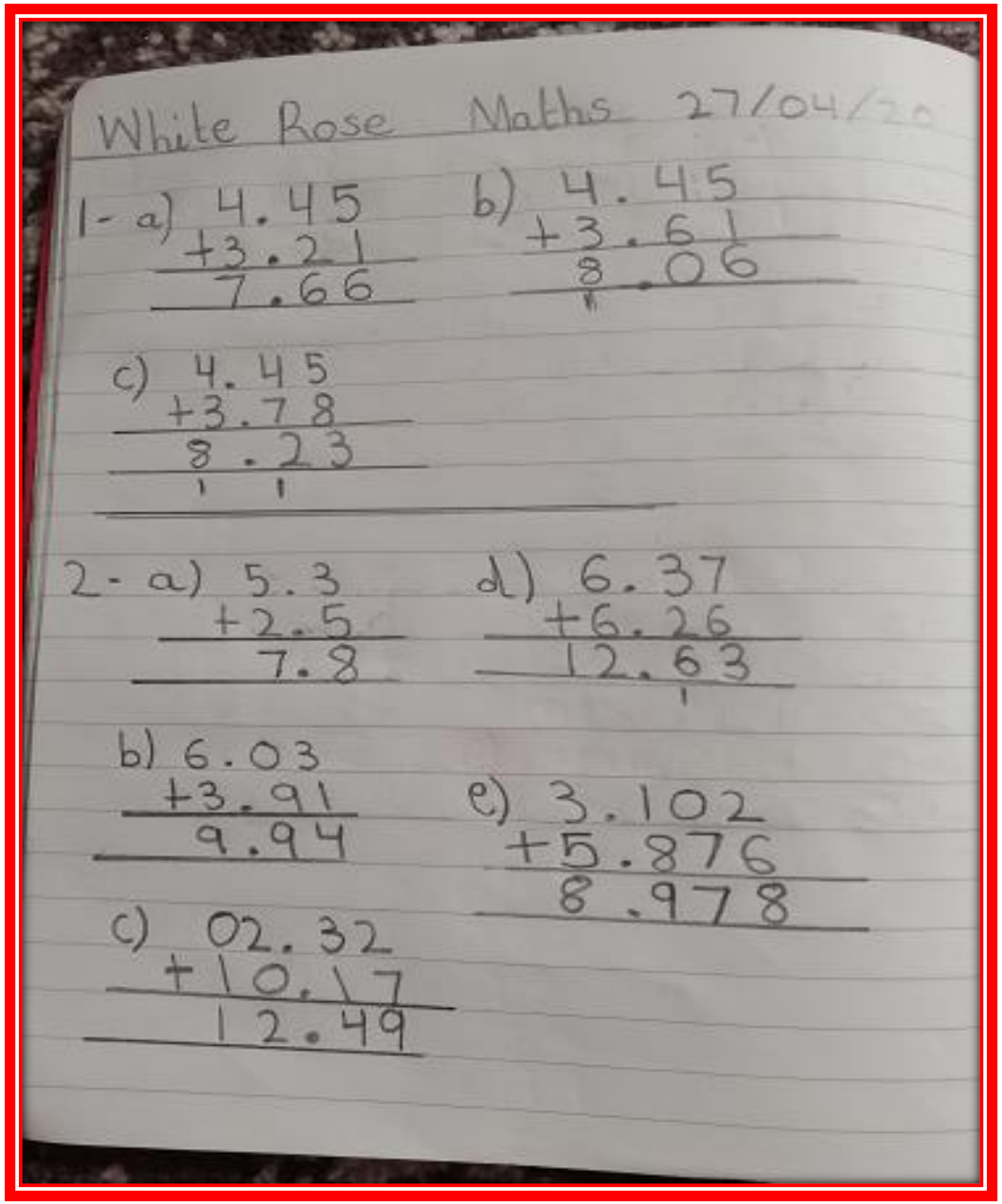

White Rose Maths 27/04/20

1- a) 4.45
+3.21
7.66

b) 4.45
+3.61
8.06
1

c) 4.45
+3.78
8.23
1 1

2- a) 5.3
+2.5
7.8

b) 6.03
+3.91
9.94

c) 02.32
+10.17
12.49

d) 6.37
+6.26
12.63
1

e) 3.102
+5.876
8.978

Maths – Decimals

Hadiyah – Year 5

Literacy- Questions- Chapter 3

1: Alba drops the meat at Livia's paws because she remembers her place, second and how Livia is the leader. Alba wants to respect her.

2: Livia backs away from the girl because her old alpha used to say 'Never trust a two-legged. You never know what will happen.'

3: Alba is saved from being squished by part of a building (a rock), but Livia saves her by pushing her aside.

4: The new dog that is mentioned in this chapter is called 'Delta' and she is on the other side of the gate. Claudia wants to go and check her out but Livia refuses to let her go there.

5: Alba thinks that this new dog is scared and a bit of a coward. Because she says 'Delta will be cowering in a corner, waiting for the two-legs to release her'.

Literacy- Questions- Chapter 4

1: I think the ground feels warm under the dogs' paws because a volcano is going to erupt. I think that because there is also a picture on page 16 of a volcano.

2: Cato means by 'stone nests' that is a house or a building. Therefore it said the 'two-legs' and that's what the animals call humans.

3: Cato advises to leave the town or go somewhere away from here, like the rest already did.

4: I think that Livia was being fair to Claudia because she can't always be nice and gentle. When Claudia wasn't listening, Livia needed a way to get her attention. So she growled to show that she was serious.

5: I think that a volcano will erupt and the pack will escape, but Livia takes the girl and her family somewhere safe. The pack doesn't find each other for a long time, and when they do, they celebrate!

English – Reading Comprehension

Julia – Year 5

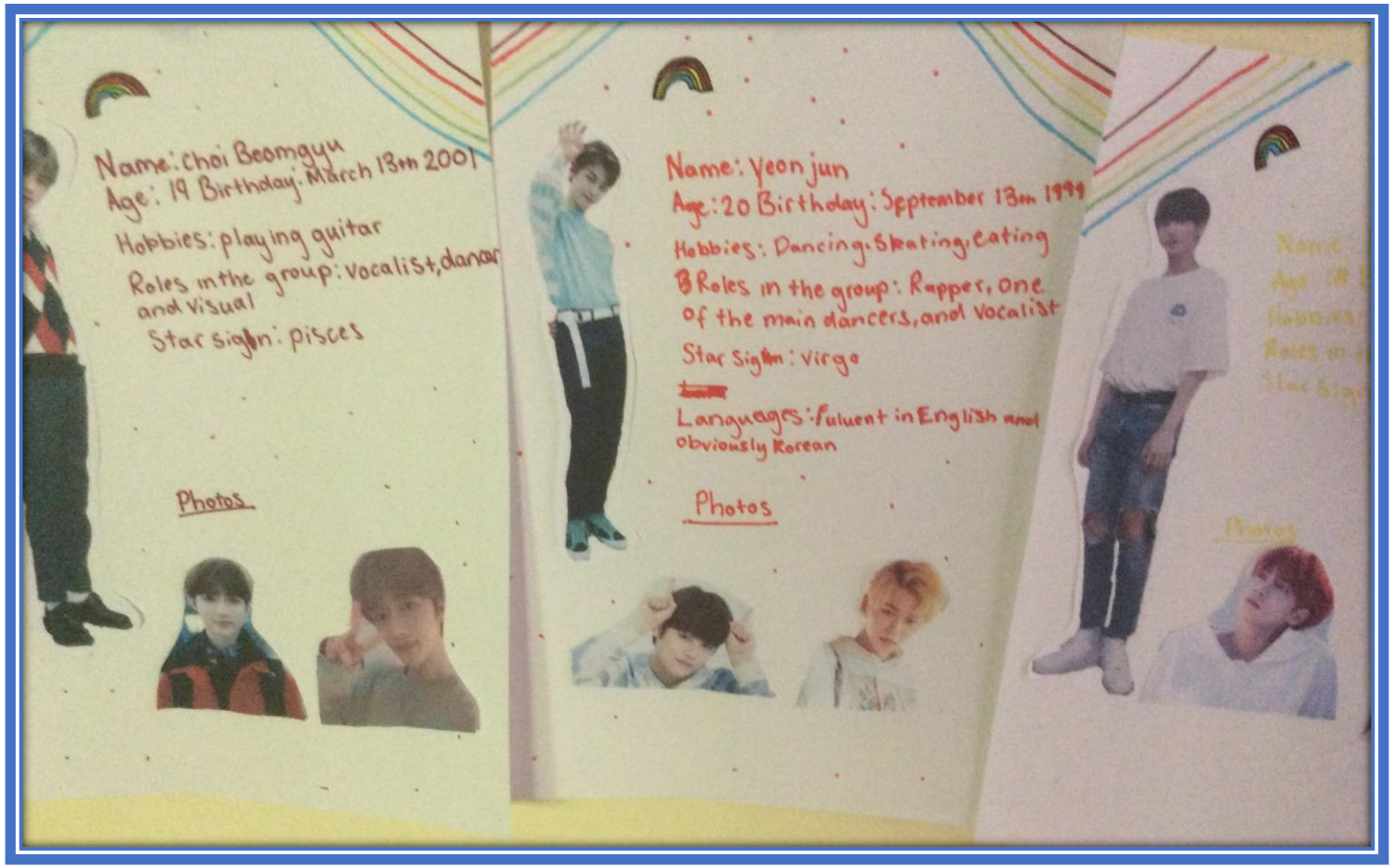

Music – Artist Fact File

Elizabeth – Year 6

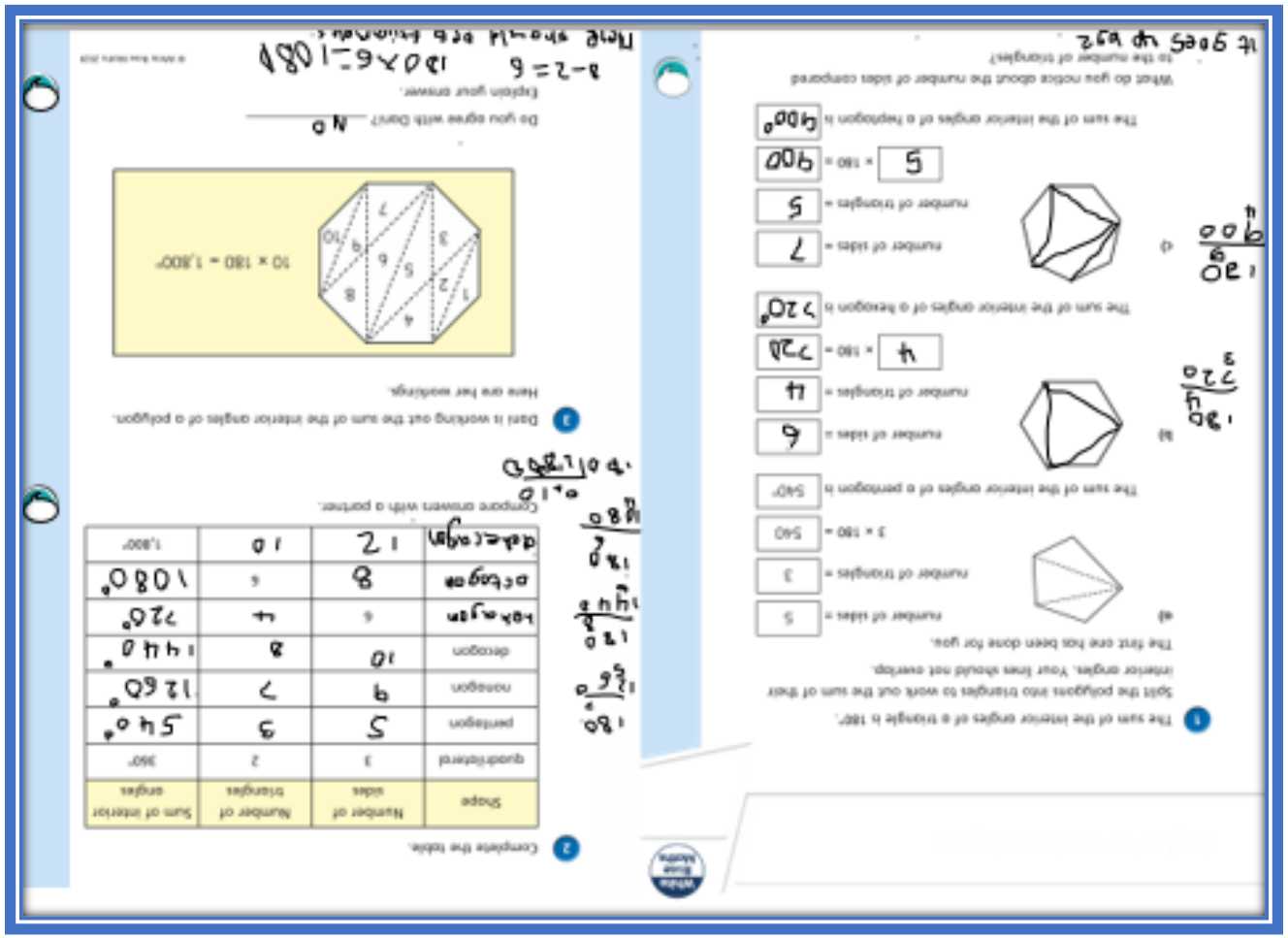

1 The sum of the interior angles of a triangle is 180°.
Split the polygons into triangles to work out the sum of their interior angles. Your lines should not overlap.
The first one has been done for you.

a) number of sides = 5
number of triangles = 3
3 × 180 = 540
The sum of the interior angles of a pentagon is 540°

b) number of sides = 6
number of triangles = 4
4 × 180 = 720
The sum of the interior angles of a hexagon is 720°

c) number of sides = 7
number of triangles = 5
5 × 180 = 900
The sum of the interior angles of a heptagon is 900°

What do you notice about the number of sides compared to the number of triangles?
It goes up by 2

2 Complete the table.

Shape	Number of sides	Number of triangles	Sum of interior angles
quadrilateral	3	2	360°
pentagon	5	3	540°
nonagon	9	7	1260°
decagon	10	8	1440°
hexagon	6	4	720°
octagon	8	6	1080°
dodecagon	12	10	1,800°

Compare answers with a partner.

3 Dani is working out the sum of the interior angles of a polygon.
Here are her workings.

10 × 180 = 1,800°

Do you agree with Dani? No
Explain your answer.
8 − 2 = 6 180 × 6 = 1080
Make sure all sides are included

© 2019 Bill Hemry 2019

Maleha – Year 5

Art

Milly – Year 5

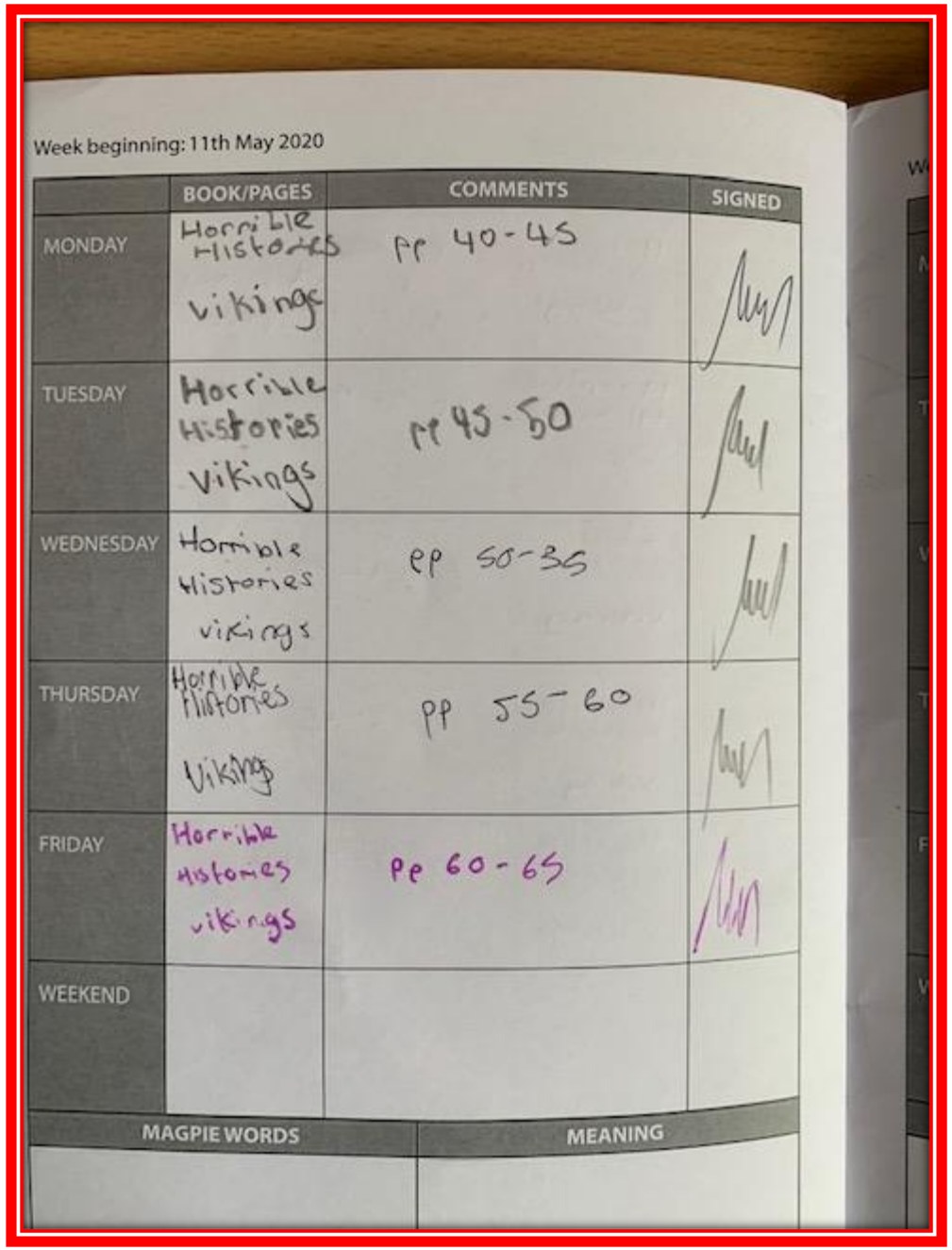

Week beginning: 11th May 2020

	BOOK/PAGES	COMMENTS	SIGNED
MONDAY	Horrible Histories vikings	pp 40-45	
TUESDAY	Horrible Histories vikings	pp 45-50	
WEDNESDAY	Horrible Histories vikings	pp 50-35	
THURSDAY	Horrible Histories vikings	pp 55-60	
FRIDAY	Horrible Histories vikings	pp 60-65	
WEEKEND			

MAGPIE WORDS	MEANING

Reading

Milly – Year 5

Milly – Year 5

1. a) 4.45 + 3.21 = 7.66

ones	tenths	hundreths
7	6	6

b) 4.45 + 3.61 = 8.06 | 18.05.20

Ones	tenths	hundreths
0000	000	00000
00	000	
00	0	0

2. a) 5.3 + 2.5 = 7.8

b) 6.03 + 3.91 = 9.94

c) 2.32 + 10.17 = 12.49

d) 6.37 + 6.26 = 12.63

e) 3.102 + 5.876 = 8.978

f) 12.034 + 9.227 = 21.261

g) 5.75 + 5.32 = 5.01 = 16.08

h) 14.99 + 12.37 = 27.36

3. a) 0.64 + 4.79 $\boxed{>}$ 5.01 + 0.23

b) 7.427 + 3.238 $\boxed{<}$ 5.427 + 5.832

c) 3.08 + 4.63 $\boxed{=}$ 4.84 + 2.87

4. Teddy's mistake is that he moved the decimal. The decimal has to always stay in the same spot.

5. perimeter = 27.6 cm

6. 3.65 +1.78 → 5.43 +1.78 → 7.21 +1.78 → 8.99

7. No

Maths – Decimals

Muskan – Year 5

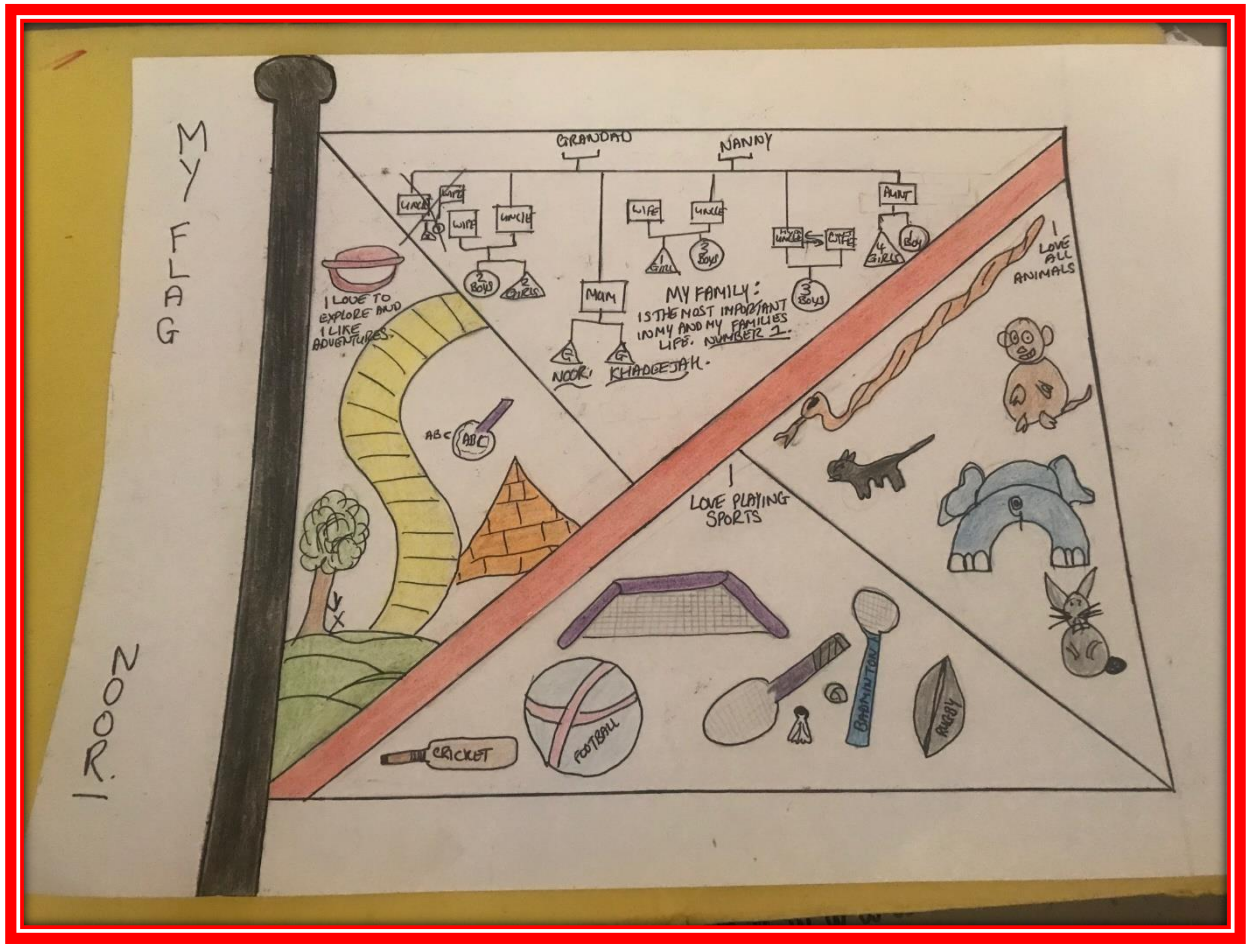

Art – Flag Design

Noor – Year 5



Topic – Viking Gods

Sofia – Year 5

Art

Timas – Year 5

Kate Krayz was quite an interesting girl. How you may ask?... she had 50 cats! That's why her friends call her Kat. She had long, brown, wavy hair and wore black glasses. Also she often had her hair out. She often wore jumpers and hoodies, with tights underneath her shorts. Where ever she went she had a cat or two with her in her hood and in a specially made pouch at the front of her hoodie. Her favourite shoes were brown lace up boots (that she always wore) that her cats love to play with. She was going the shop to buy vegetables for her mum to make dumplings and stir fry. "Konachwa" she said to the shop keeper. "Kon'nichwa" the shop keeper corrected her. She tried to say it again without her American accent. She put all of the veg on the counter including a Willy Wonka's whipple – scrumptious fudge mallow delight. Little did she know her life was about to change forever! When she arrived home, she passed the bag of vegetables to her mum and took the chocolate bar to her room. But before opening it she spent 20 minutes saying hello to all her 50 cats, individually... by name! "Now," she said to herself "let's have some chocolate." As she gently and slowly freed it from the wrapper, her eyes widened in shock. She had found one of the six golden tickets! She couldn't believe her eyes. It glowed like a million stars. "Meow, meow, meow!" she screamed to her cats. She ran to the kitchen to show her mum, as fast as her little legs could carry her. Kat was so out of breath that when she got there she could barely say a word.

English

Aleeza – Year 6

Viking Brooch

Max – Year 5

Land Art

Maliha – Year 5

Maze making -STEM

Max – Year 5

Land Art Collage

Adam – Year 5

Gratitude

Michal – Year 5



Maths - Decimals

Dagmara – Year 5



Mathletics

Michal – Year 5



Mathletics

Adam – Year 5

Mathletics

Michal – Year 5